Recognising coins

1 Match the coin to the amount.

20 pence
5 pence
10 pence
1 pound
1 pence
50 pence
2 pence
2 pounds

2 Here are some coins.

Complete the sentences.

There are ☐ 1p coins.

There are ☐ 2p coins.

There is ☐ 5p coin.

There are ☐ 10p coins.

There are ☐ 20p coins.

3 Write < or > to compare the amounts.

a) ◯

b) ◯

c) 

d) 

4 Mo has one coin in his hand.



Draw Mo's coin.

What is the value of Mo's coin? ☐ p

Is there more than one answer?

© White Rose Maths 2020